REVISED 7/14/2015

Released Form

North Carolina READY End-of-Grade Assessment Mathematics

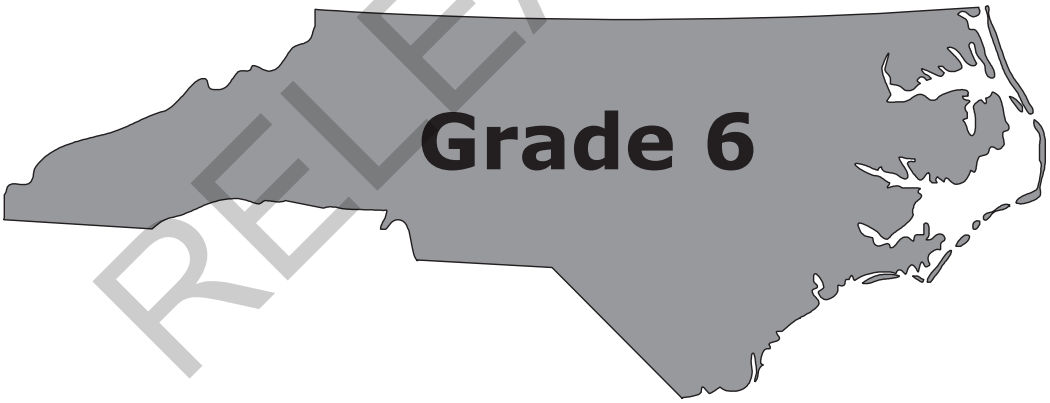

RELEASED

Student Booklet

Academic Services and Instructional Support
Division of Accountability Services

Copyright © 2013 by the North Carolina Department of Public Instruction. All rights reserved.

Sample Questions

S1 Kerry walks 3 miles each day. How far will she walk in 7 days?

A 10 miles

B 14 miles

C 21 miles

D 24 miles

S2 What number is represented by point *P* on the number line below?

S3 What fraction of the circle is shaded?

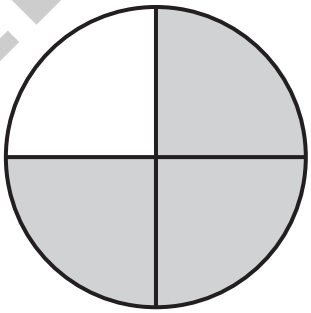

RELEASED

STOP

1 Joe will go to the swimming pool on 20 different days this month.

- A one-day pass to the pool is $2.25.
- A monthly pass to the pool is $30.00.

How much money will Joe save by buying a monthly pass?

A $20

B $18

C $15

D $12

2 A rectangular parking lot has an area of $\frac{2}{3}$ of a square kilometer. The width is $\frac{1}{2}$ of a kilometer. What is the length, in kilometers, of the parking lot?

A $\frac{1}{3}$

B $\frac{2}{3}$

C $1\frac{1}{3}$

D $1\frac{2}{3}$

RELEASED

3 The price of a theater ticket increased from \$7.50 to \$7.75. The theater sold 315 tickets at the higher price. With the price increase, how much more did the theater earn on the tickets?

A \$78.00

B \$78.25

C \$78.50

D \$78.75

4 Hannah babysits to earn money.

- She charges \$6.50 to babysit for the first hour.
- She charges \$5.75 for each additional hour.
- Let n equal the number of hours after the first hour.

Which expression represents how much Hannah charges?

A $12.25n$

B $6.50 + 5.75n$

C $6.50n + 5.75$

D $6.50n + 5.75n$

RELEASED

5 What is the value of $\left(\frac{1}{7}\right)^3$?

A $\frac{3}{7}$

B $\frac{1}{7}$

C $\frac{3}{343}$

D $\frac{1}{343}$

6 Which choice shows a set of data that could be represented by the box plot shown below?

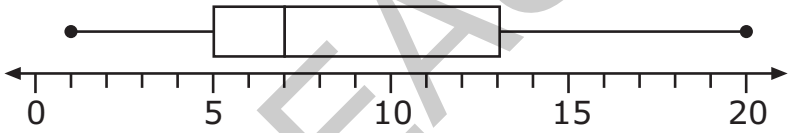

A 1, 3, 5, 6, 7, 7, 8, 13, 19, 20

B 1, 3, 5, 6, 6, 8, 13, 14, 19, 20

C 1, 2, 3, 5, 7, 8, 8, 13, 19, 20

D 1, 5, 5, 6, 6, 6, 8, 13, 19, 20

RELEASED

Questions 7 through 15 require you to write your answers in the boxes provided on your answer sheet. Write only one number or symbol in each box and fill in the circle in each column that matches what you have printed. Fill in only one circle in each column.

7 A recipe requires $\frac{1}{4}$ lb of onions to make 3 servings of soup. Mark has $1\frac{1}{2}$ lb of onions. How many servings can Mark make?

8 A rectangular room has an area of $131\frac{1}{4}$ square feet. The length of the room is $12\frac{1}{2}$ feet. What is the width, in feet, of the room?

9 Allen is building birdhouses that require $\frac{1}{2}$-ft-long boards. How many pieces that are exactly $\frac{1}{2}$ ft long can be made from a board that is $8\frac{1}{4}$ ft long?

RELEASED

10 How much money should John get back when he uses $10.00 to pay for purchases totaling $5.25?

Express the answer as dollars.cents.

11 What is the product of 2.52 and 3.4?

12 At a store, Susan selected a pumpkin that weighed 35.2 ounces.

- Pumpkins cost $1.80 per pound.
- There are 16 ounces in 1 pound.

How much did Susan's pumpkin cost?

Express the answer as dollars.cents.

RELEASED

13 What is the greatest whole number that is less than $\left(\frac{5}{2}\right)^3 \div \left(\frac{3}{4}\right)^2$?

14 What is the value of $\frac{1}{3}x^2 + 2$, when $x = 3$?

15 Heather earns $8.00 per hour for walking a dog. How many hours must she work to earn $256.00?

RELEASED

This is the end of the calculator inactive test questions.

Directions:

1. **Look back over your answers for the calculator inactive questions. You will not be able to go back and work on these questions once you are given a calculator.**

2. **Raise your hand to let your teacher know you are ready to begin the calculator active test questions.**

3. **Do not begin work on the calculator active test questions until your teacher has given you a calculator.**

RELEASED

STOP

16 One serving of Mike's crackers has 150 calories and a mass of 30 grams. How many calories are in 6 grams of the crackers?

A 5

B 10

C 25

D 30

17 The ratio of nitrogen to potassium in a sample of soil is 12:9. The sample has 36 units of nitrogen. How much potassium does the sample have?

A 21 units

B 27 units

C 33 units

D 48 units

18 To clean a tank, $\frac{3}{4}$ cup of disinfectant is needed for every 2 gallons of water. How many cups of disinfectant are needed for 20 gallons of water?

A $7\frac{1}{2}$

B 15

C $22\frac{1}{2}$

D 30

RELEASED

19 A laundry detergent is sold at four stores.

Store	**Size** (ounces)	**Price**
Hawkin's Store	60	$6.50
Don's Store	54	$5.50
Allen's Market	48	$5.61
Value Market	40	$4.50

Which store has the lowest price per ounce?

A Hawkin's Store

B Don's Store

C Allen's Market

D Value Market

20 Marcy is taking two types of medicine.

- She takes one medicine every 6 hours.
- She takes the other medicine every 4 hours.
- She takes both medicines at 9:00 a.m.

At what time will Marcy take both medicines together again?

A 1:00 p.m.

B 3:00 p.m.

C 5:00 p.m.

D 9:00 p.m.

RELEASED

21 Jeff recorded the average temperatures for six months. He will display the temperatures on a number line.

Month	**Temperature** (°F)
December	$^{-}5$
January	$^{-}16$
February	$^{-}15$
March	20
April	24
May	35

On the number line, which month's temperature will be between February's and March's temperatures?

A December

B January

C April

D May

22 A trapezoid in a coordinate plane has vertices $(^{-}2, 5)$, $(^{-}3, {}^{-}2)$, $(2, {}^{-}2)$, and $(1, 5)$. What is the height of the trapezoid?

A 3 units

B 5 units

C 7 units

D 9 units

RELEASED

23 Which can be represented by the expression $17 - 2x$?

A 17 less than twice a number x

B the difference between 17 and twice a number x

C a number x squared, subtracted from 17

D 17 less than a number x squared

24 Which expression is equivalent to $5y + 2y + 6x + 2y - x$?

A $5x + 6y$

B $5x + 7y$

C $5x + 9y$

D $7x + 7y$

25 Diana can use the equation $y = 7x$ to calculate her pay, where y represents the amount of pay, and x represents the number of hours worked. How many hours did Diana work if she was paid $45.50?

A 5.5 hours

B 6 hours

C 6.5 hours

D 7 hours

RELEASED

26 If $y - 18 = 14$, what is the value of $3(y + 5)$?

A 27

B 32

C 96

D 111

27 Karen recorded her walking pace in the table below. What equation ***best*** represents this relationship?

Hours Walked (h)	**Miles Walked** (m)
2.5	8.75
4	14

A $h = m + 10$

B $h = 3.5m$

C $m = h + 10$

D $m = 3.5h$

RELEASED

28 The shaded area indicates the parking lot at a shopping center.

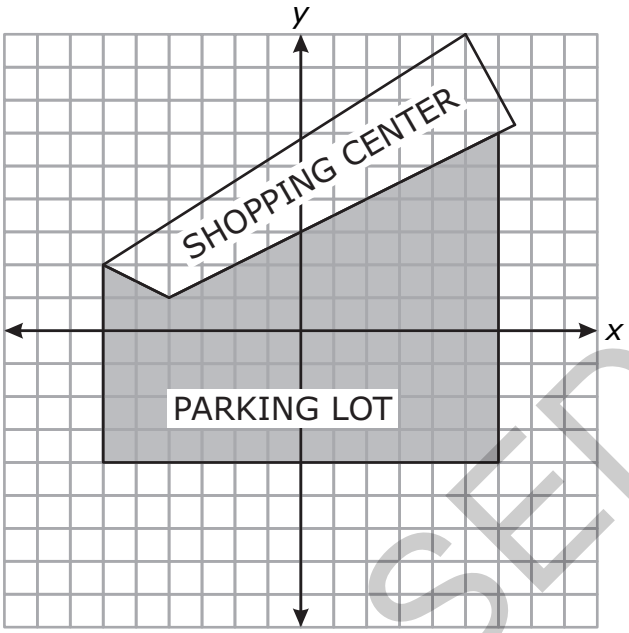

What is the total area of the parking lot?

A 72 units^2

B 86 units^2

C 91 units^2

D 120 units^2

RELEASED

29 The right rectangular prism below is made up of 8 cubes. Each cube has an edge length of $\frac{1}{2}$ inch.

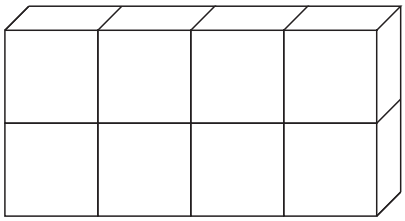

What is the volume of this prism?

A 1 cubic inch

B 2 cubic inches

C 4 cubic inches

D 8 cubic inches

30 What is the area of the quadrilateral with vertices at ($^{-}1$, 0), (2, 0), (2, 5), and ($^{-}1$, 5)?

A 15 square units

B 12 square units

C 10 square units

D 5 square units

RELEASED

31 The net of a triangular right prism is shown below.

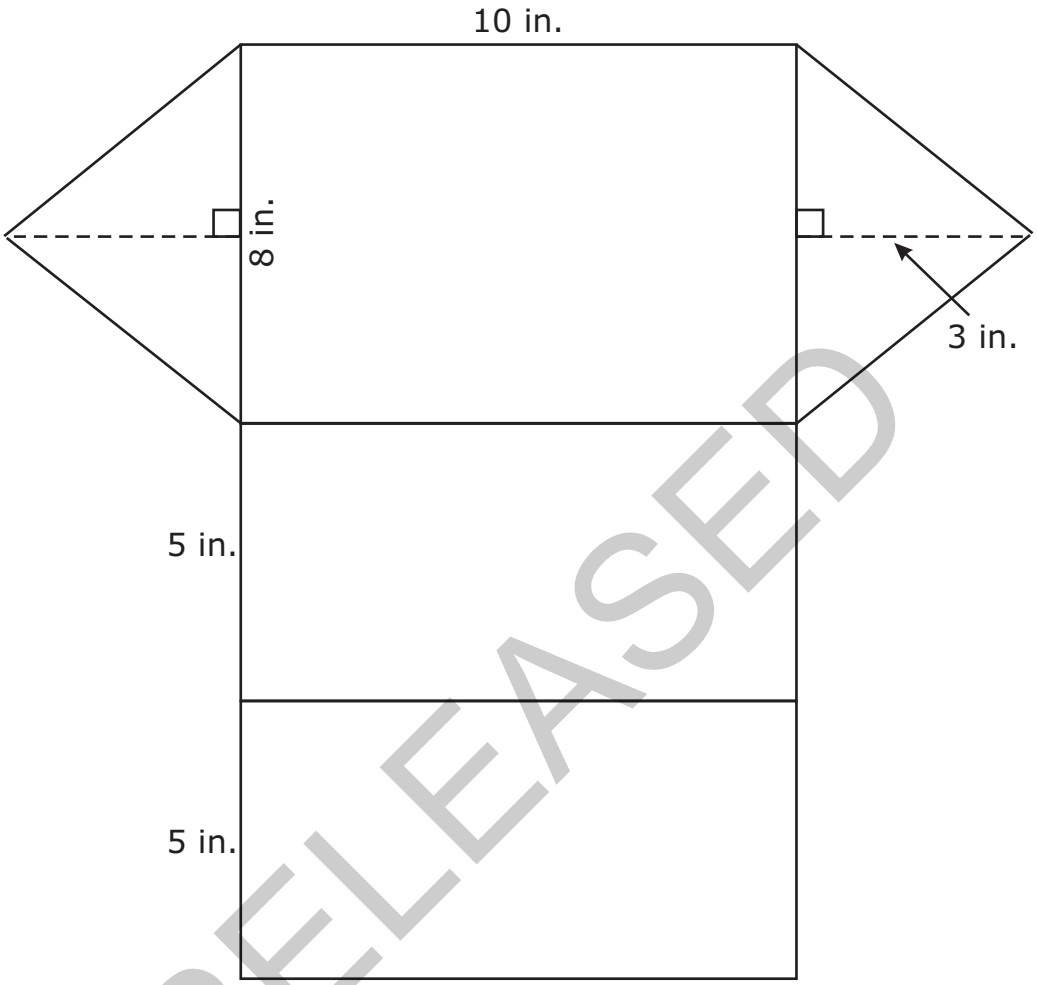

RELEASED

What is the surface area of the prism?

A 204 in.^{2}

B 228 in.^{2}

C 240 in.^{2}

D 288 in.^{2}

32 The data below represents the numbers of books that twelve students read.

2, 4, 7, 8, 9, 12, 14, 18, 19, 21, 30, 32

Which box plot correctly summarizes the data?

A

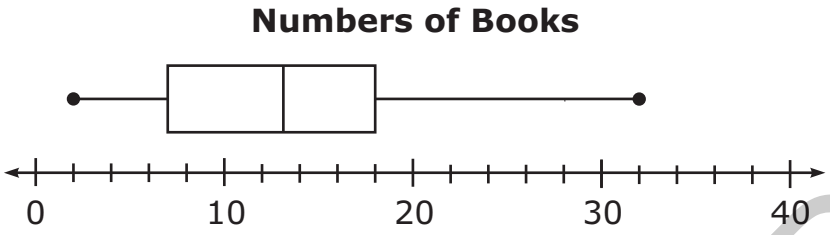

B

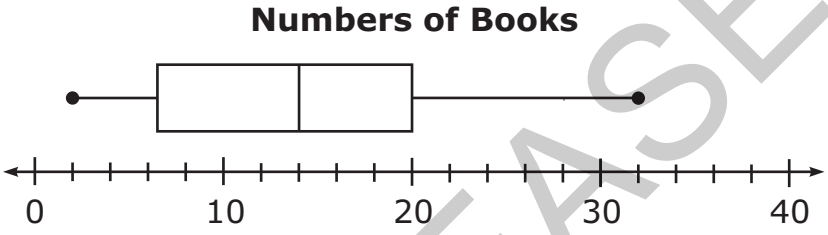

C

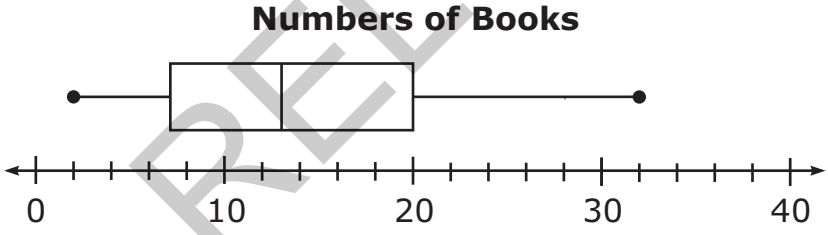

D

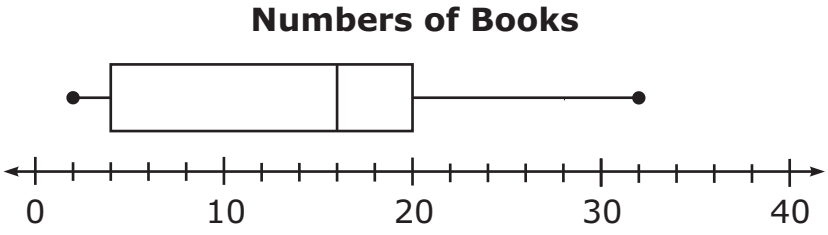

RELEASED

33 Which box plot represents a set of data with the largest interquartile range?

A

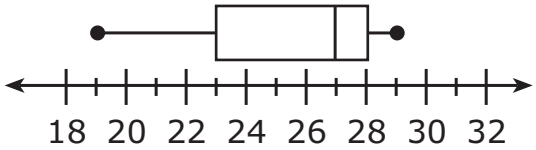

B

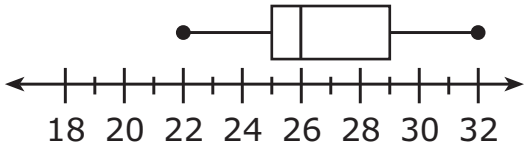

C

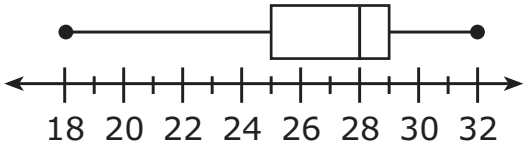

D

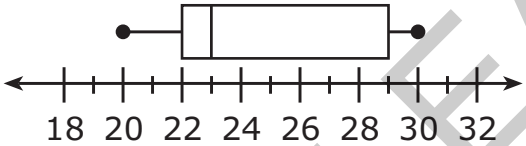

RELEASED

34 A company that makes boxes finds that 3 out of 20 boxes are damaged. What percent of the boxes are damaged?

A 12%

B 15%

C 25%

D 34%

35 Jack drew a number line on his paper.

Jack drew a new point 45% of the distance from point *E* to point *J*. Between which two letters does the new point lie?

A *G* and *H*

B *I* and *J*

C *F* and *G*

D *H* and *I*

36 Valerie is 64 inches tall. ***About*** how many centimeters tall is Valerie?
(1 inch ≈ 2.5 centimeters)

A 25.6

B 30.6

C 160

D 180

RELEASED

37 Which point on the number line represents the number $^{-}4\frac{1}{2}$?

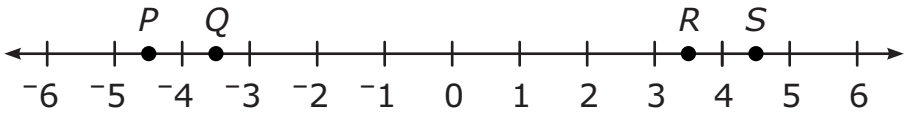

A *P*

B *Q*

C *R*

D *S*

38 This table shows the number of miles four friends travel to get to school.

Student	**Distance to School** (miles)
Andie	$1\frac{3}{8}$
Helen	$1\frac{2}{3}$
Michelle	$1\frac{5}{9}$
Troy	$1\frac{4}{9}$

Who travels the greatest distance to school?

A Andie

B Helen

C Michelle

D Troy

39 In the coordinate plane, what is the distance between $(^{-}3, 5)$ and $(^{-}3, ^{-}8)$?

A 3 units

B 6 units

C 8 units

D 13 units

RELEASED

40 Which choice is equivalent to the expression $4(x + 2y)$?

A $4x + 8y$

B $4x + 2y$

C $x + 8y$

D $8xy$

41 Which expression represents the perimeter of the triangle?

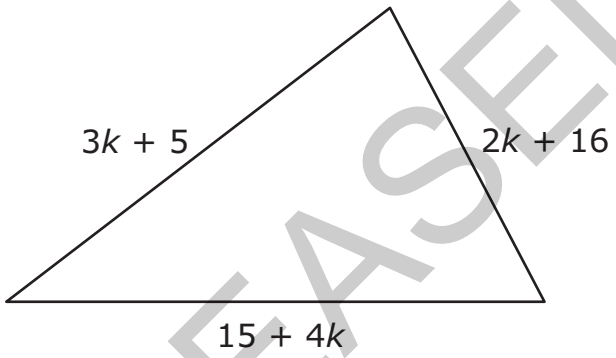

A $9k + 36$

B $10k + 25$

C $20k + 25$

D $24k + 36$

RELEASED

42 The length of a rectangle is 6 units longer than the width, w. Which choice is a correct expression for the perimeter of the rectangle?

A $2w + 6$

B $2w + 12$

C $4w + 6$

D $4w + 12$

43 Jane wants to visit her sister.

- Her car travels x miles per gallon of gas.
- She will travel 1,000 miles to her sister's house.
- Gas costs \$3.50 per gallon.

Which expression shows how much Jane will spend for gas on the trip to her sister's house?

A $1{,}000(3.50x)$

B $3.50\left(\frac{1{,}000}{x}\right)$

C $3.50\left(\frac{x}{1{,}000}\right)$

D $1{,}000\left(\frac{1}{3.50x}\right)$

44 Suppose that a stove and a freezer together weigh at least 370 pounds. The weight of the stove is 170 pounds. Which inequality correctly describes these conditions for the weight of the freezer, f?

A $f \geq 200$

B $f > 200$

C $f \leq 200$

D $f < 200$

RELEASED

45 The Wilsons want to put outdoor carpet on their porch.

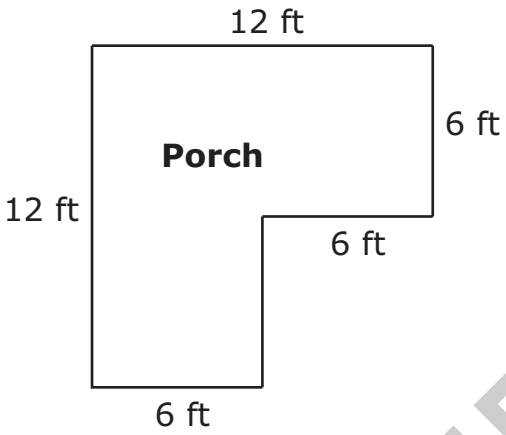

How much carpet will be needed for their porch?

A 42 ft^2

B 72 ft^2

C 108 ft^2

D 144 ft^2

RELEASED

46 What is the volume of the right rectangular prism below?

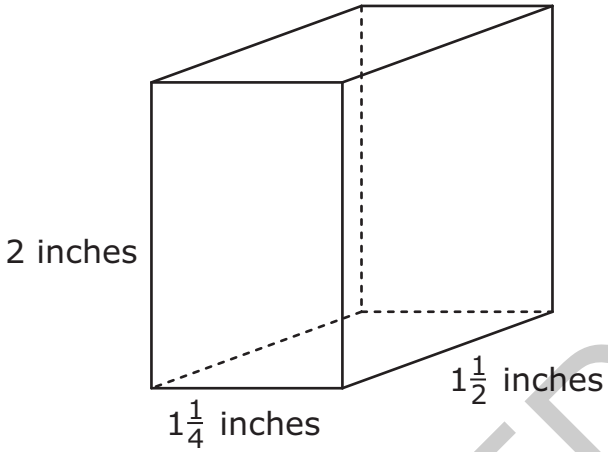

A $4\frac{3}{4}$ cubic inches

B $4\frac{1}{8}$ cubic inches

C $3\frac{3}{4}$ cubic inches

D $2\frac{1}{8}$ cubic inches

RELEASED

47 In the graph below, each grid square represents one square yard.

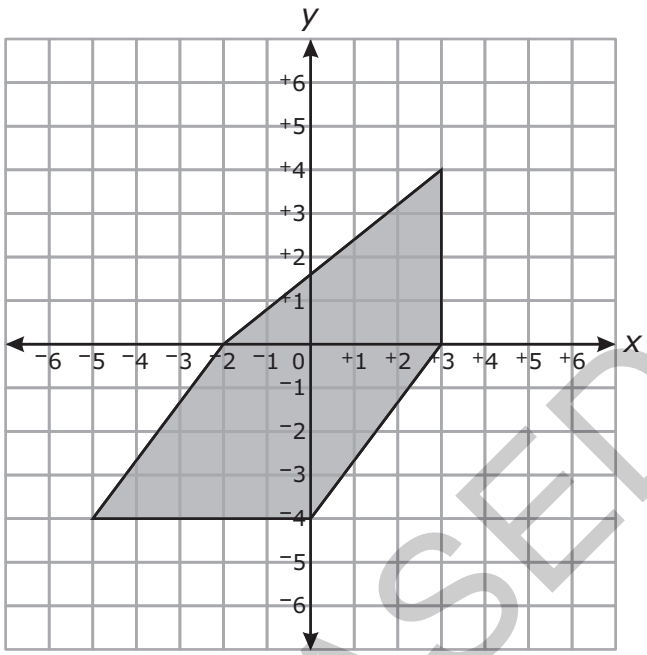

What is the area of the shaded figure?

A 20 yd^2

B 30 yd^2

C 36 yd^2

D 40 yd^2

RELEASED

48 Abby is making a decoration. When folded, the decoration is a triangular pyramid made of four congruent equilateral triangles. ***Approximately***, what is the surface area of Abby's decoration?

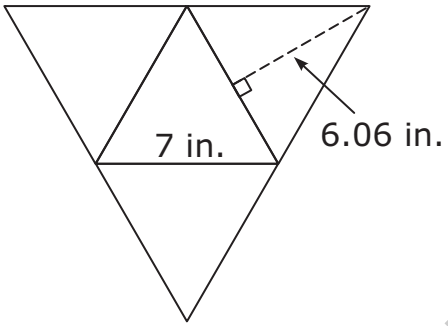

A 64 in.^{2}

B 85 in.^{2}

C 97 in.^{2}

D 170 in.^{2}

49 Katherine earned 84, 92, 84, 75, and 70 on her first 5 tests. What is the minimum grade Katherine needs to earn on the next test to have a mean of 84?

A 81

B 84

C 95

D 99

RELEASED

50 The weather station recorded the high temperature each day for 30 days. The graph of the temperature data is shown below.

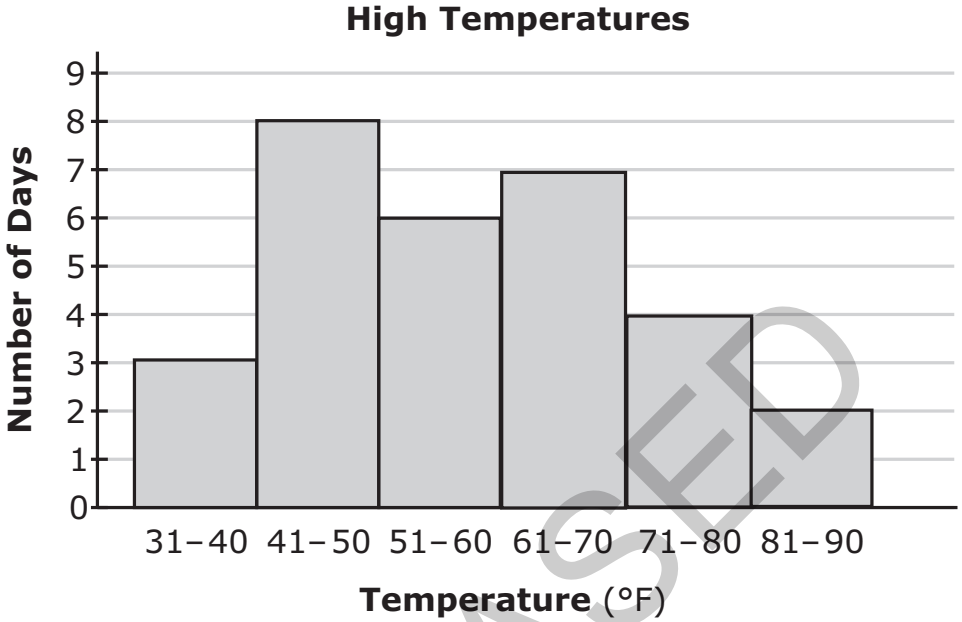

In which interval is the median temperature?

A 41–50

B 51–60

C 61–70

D 71–80

RELEASED

Directions:

This is the end of the mathematics test.

1. **Put all of your papers inside your test book and close your test book.**

2. **Place your calculator on top of the test book.**

3. **Stay quietly in your seat until your teacher tells you that testing is finished.**

RELEASED

STOP

Grade 6 Math
RELEASED Form
2012–2013
Answer Key

Item Number	Type	Key	Domain
S1	MC	C	
S2	GR	-7	
S2	GR	$\frac{3}{4}$ or .75	

Calculator Inactive

Item Number	Type	Key	Domain
1	MC	C	CCSS.MATH.CONTENT.6.NS.B.3
2	MC	C	CCSS.MATH.CONTENT.6.NS.A.1
3	MC	D	CCSS.MATH.CONTENT.6.NS.B.3
4	MC	B	CCSS.MATH.CONTENT.6.EE.B.6
5	MC	D	CCSS.MATH.CONTENT.6.EE.A.1
6	MC	A	CCSS.MATH.CONTENT.6.SP.B.4
7	GR	18	CCSS.MATH.CONTENT.6.NS.A.1
8	GR	10.5	CCSS.MATH.CONTENT.6.NS.A.1
9	GR	16	CCSS.MATH.CONTENT.6.NS.A.1
10	GR	4.75	CCSS.MATH.CONTENT.6.NS.B.3
11	GR	8.568	CCSS.MATH.CONTENT.6.NS.B.3
12	GR	3.96	CCSS.MATH.CONTENT.6.NS.B.3
13	GR	27	CCSS.MATH.CONTENT.6.EE.A.1
14	GR	5	CCSS.MATH.CONTENT.6.EE.A.2.C
15	GR	32	CCSS.MATH.CONTENT.6.EE.B.7

RELEASED

Calculator Active

Item Number	Type	Key	Domain
16	MC	D	CCSS.MATH.CONTENT.6.RP.A.3.A
17	MC	B	CCSS.MATH.CONTENT.6.RP.A.3.A
18	MC	A	CCSS.MATH.CONTENT.6.RP.A.3.B
19	MC	B	CCSS.MATH.CONTENT.6.RP.A.3.B
20	MC	D	CCSS.MATH.CONTENT.6.NS.B.4
21	MC	A	CCSS.MATH.CONTENT.6.NS.C.7.B
22	MC	C	CCSS.MATH.CONTENT.6.NS.C.8
23	MC	B	CCSS.MATH.CONTENT.6.EE.A.2.A
24	MC	C	CCSS.MATH.CONTENT.6.EE.A.3
25	MC	C	CCSS.MATH.CONTENT.6.EE.B.7
26	MC	D	CCSS.MATH.CONTENT.6.EE.B.7
27	MC	D	CCSS.MATH.CONTENT.6.EE.C.9
28	MC	B	CCSS.MATH.CONTENT.6.G.A.1
29	MC	A	CCSS.MATH.CONTENT.6.G.A.2
30	MC	A	CCSS.MATH.CONTENT.6.G.A.3
31	MC	A	CCSS.MATH.CONTENT.6.G.A.4
32	MC	C	CCSS.MATH.CONTENT.6.SP.B.4
33	MC	D	CCSS.MATH.CONTENT.6.SP.B.5.C
34	MC	B	CCSS.MATH.CONTENT.6.RP.A.3.C
35	MC	A	CCSS.MATH.CONTENT.6.RP.A.3.C
36	MC	C	CCSS.MATH.CONTENT.6.RP.A.3.D
37	MC	A	CCSS.MATH.CONTENT.6.NS.C.6.C

RELEASED

Item Number	Type	Key	Domain
38	MC	B	CCSS.MATH.CONTENT.6.NS.C.7.B
39	MC	D	CCSS.MATH.CONTENT.6.NS.C.8
40	MC	A	CCSS.MATH.CONTENT.6.EE.A.3
41	MC	A	CCSS.MATH.CONTENT.6.EE.A.3
42	MC	D	CCSS.MATH.CONTENT.6.EE.A.3
43	MC	B	CCSS.MATH.CONTENT.6.EE.B.6
44	MC	A	CCSS.MATH.CONTENT.6.EE.B.8
45	MC	C	CCSS.MATH.CONTENT.6.G.A.1
46	MC	C	CCSS.MATH.CONTENT.6.G.A.2
47	MC	B	CCSS.MATH.CONTENT.6.G.A.3
48	MC	B	CCSS.MATH.CONTENT.6.G.A.4
49	MC	D	CCSS.MATH.CONTENT.6.SP.B.5.C
50	MC	B	CCSS.MATH.CONTENT.6.SP.B.5.C

Item Types:

MC = multiple choice GR = gridded response

Links to instructions for the gridded-response items can be found on the main accountability page.

RELEASED